Prénom : _____ Date: _____

Mesure : La monnaie

1 Relie chaque produit aux pièces nécessaires pour les acheter :

boîte de haricots verts
55 centimes

bouteille d'eau
75 centimes

bouteille de lait
87 centimes

boîte de thon
69 centimes

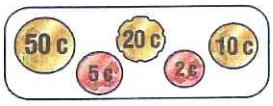

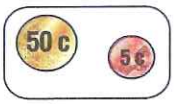

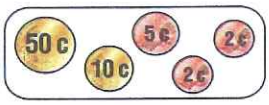



2 Entoure la somme nécessaire :

baguette : 95 centimes

petits pains grillés : 77 centimes





3 Complète :

2 € 70 c

..... € c

..... € c

4 Dessine la somme d'argent nécessaire avec le moins de pièces possible :

brioche : 85 centimes



croissant : 93 centimes



Marie-Laure©Ecoledecerevette

Prénom : _____ Date: _____

Mesure : La monnaie

1 Barre les pièces et les billets en trop :

1 € 47 c

7 € 25 c

4 € 84 c

2 Fais des groupes de 1 € puis écris la somme totale :

100c = 1€

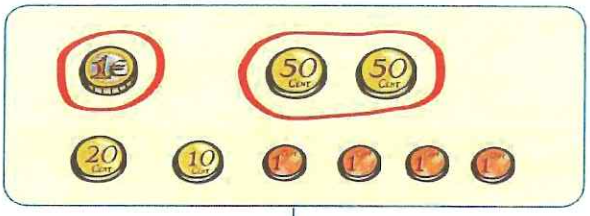

2 € 34 c

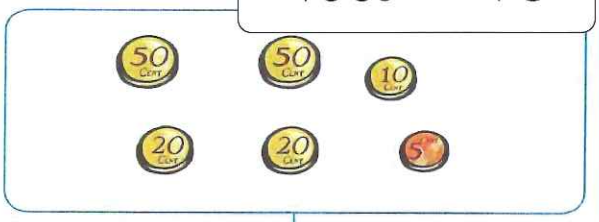

..... € c

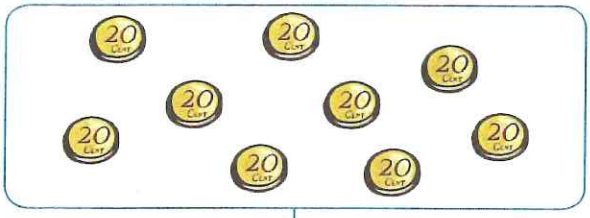

..... € c

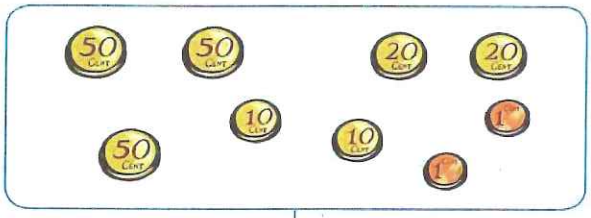

..... € c

3 Ecris le prix de ces jeux en centimes, puis en euros et en centimes :

..... centimes

= ..... euro et ..... centimes

..... centimes

= ..... euros et ..... centimes

Marie-Laure©Ecoledecrevette